walimuepublishers@gmail.com

STEP FLYER EXAMS

CLASS 7

SERIES 006-19

FOR MARKING SCHEMES CALL 0705525657



SCHOOL BASED EVALUATION TEST

STANDARD SEVEN - YEAR 2019

STEP FLYER 006

ENGLISH:LANGUAGE

7

Time: 1hrs 40 min

READ THESE INSTRUCTIONS CAREFULLY.

1. You have been given this question paper and a separate answer sheet. The question paper contains 50 questions.
2. Make sure that you have written on the answer sheet.
   (i) Your name *(ii) Name of your school*

Read the passage below . It contains blank spaces numbered 1-15. For blank spaces choose the best alternative from the choices given

"Where is the rest of the change?" ___1___ Tony's mother." ___2___to the shops this minute___3___ bring my money. I often ___4___ whether you ___5___ learn ___6___at school."

Tony ___7___ back to the shops feeling upset and confused. He was the ___8___ pupil in his class and his teacher was very proud___9___ him, ___10___his mother was always finding ___11___ with him. It was not his his fault that they did not___12___ real money at school. He was ___13___ good at counting with stones and bottle-tops. He ___14___they ___15___ learn about those things that his mother wanted him to know. He really did not like to annoy her.

1.	**A.** screamed	**B.**ordered	**C.**asked	**D.**said
2.	**A.**Return	**B.**Ran	**C.**Shuffle	**D.**Return back
3.	**A.**as well	**B.**too	**C.**or	**D.**and
4.	**A.**wondered	**B.**wonder	**C.**wander	**D.**wandered
5.	**A.** never	**B.**ever	**C.**least	**D.**did
6.	**A.**anything	**B.**something	**C.**any thing	**D.**some thing
7.	**A.**strolled	**B.**skipped	**C.**run	**D.**ran
8.	**A.**most good	**B.**better	**C.**best	**D.**more better
9.	**A.**in	**B.**with	**C.**to	**D.**of
10.	**A.**yet	**B.**since	**C.**moreover	**D.**lest
11.	**A.**error	**B.**mistake	**C.**fault	**D.**issues
12.	**A.**hand	**B.**handle	**C.**catch	**D.**touch
13.	**A.**quite	**B.**so	**C.**too	**D.**such
14.	**A.**prefferred	**B.**wished	**C.**hoped	**D.**thought
15.	**A.**will	**B.**should	**C.**can	**D.**could

For questions 16 - 18, choose the correct alternative to fill the blank spaces.

16. Kitty wore a _____jacket.
    A. tight, black, silken
    B. silken, tight, black
    C. black, silken, tight
    D. black, tight, silken

17. I cannot remember anything _____was said in the seminar.
    A. what B. which
    C. that D. who

18. _____she cooked chapati, I was sweeping the compound too.
    A. since B. while
    C. when D. if

For questions 19 to 20, choose the correct question tag.

19. Kindly assist me carry this bag,_____?
    A. won't you B. is it
    C. will you D. can you

20. I am the heaviest boy in class,_____?
    A. am I not B. amn't I
    C. aren't I D. isn't it

For question 21 to 23, choose the best phrasal verb to fill in the blank space.

21. The fire fighters fought hard and long to _____the raging fire.

A. put out B. put off

C. put on D. put in

22. He was asked to_____the sweater as it was too hot.

A. put out B. take out

C. back out D. take off

23. By failing to buy me the bicycle, he simple went _____his word.

A. back on B. back in

C. back out D. back off

For questions 24 and 25, choose the opposite of the underlined word.

24. The meeting commences at noon today.

A. starts B. ends

C. begins D. continues

25. Dave the butcher sold me some tender meat.

A. strong B. rugh

C. tough D. hard

Read the passage below to answer questions 26 -38

It had been a rather long day. As Tim walked from away the hum of machines, a wry smile played at the corner of his mouth. It was the end of the month, and he had overheard his colleagues saying that their paycheques were ready. Going to the bank had become one of his most treasured moments, and he usually saved his best smile for the bank tellers when they pushed him a wad of notes across the counter.

Working for Regency Printers was not a bed of roses, and as Tim found his way out of the Design Department, a twinge of worry crossed his mind. His net salary had consistently failed to satisfy his family's growing needs. His debts were piling up, and meeting his basic requirements was a nightmare. But he was glad he was able to meet his three children's educational needs. Although his wife kept nagging him for a better life, Tim's priority was his children's needs.

Twenty minutes later, he was queuing at the bank, ATM card in hand. Tim calculated how much rent he would pay, and just like last month, the landlord would have to do with half the rent. His wife would demand a third of the salary for her monthly beauty treatment. Tim shuddered to think what would happen if he were to pay fees for his children in primary school.

"Everybody down!" It was a blood-curdling, authoritative voice.

Like tens of other clients, Tim hit the floor fast, sending his card flying from his hand. Suddenly, gunshots rent the air as four masked men, three of them toting rifles, took control of the banking hall. All were heavily built and towered over everyone else. Their dark coats fluttered as they pointed their guns from the bank workers to clients, their evil eyes taking in everything at once.

"You raise your head and I'll blast it off!" one of the robbers shouted. As he walked between the people lying on the floor, he stepped on some fingers with his heavy boots. Everybody lay face-down, and an eerie silence filled the air.

Tim could remember seeing a security vehicle outside the bank and concluded that the robbers had either come for that loot, or were using the van for their daring mission. Please God, don't let them take my card, he thought, as the heavy boots trudged out of the bank, mission accomplished. Suddenly, there were confused noises as people got up.

26. According to paragraph one, it is clear that
A. Tim was happiest at the end of the month
B. Tim would give some bankers some of his money
C. Tim had had an easy at work
D. Tim's colleagues were paid before him

27. Working for Regency was not a bed of roses means that
A. It was not a flower farm
B. It was not fragrant at all
C. It was not easy
D. It was not too difficult

28. Why did Tim seem worried as he left the design department
A. It was end month
B. He was very tired
C. His colleagues seemed happier
D. He was thinking about his meagre salary

29. Tim's financial problems included all the following **except**
A. many debts
B. children's educational needs
C. meeting basic family requirements
D. meeting his wife's expectations

30. His wife kept nagging him means that
A. She kept pleading
B. She kept complaining
C. She kept fighting
D. She kept shouting

31. During the previous month,
A. Tim paid the full rent
B. Tim used half his salary for rent
C. Tim paid half the rent
D. Tim did not pay any rent

32. Tim's landlord would normally refer to him as
A. his client B. his landlady
C. his customer D. his tenant

33. It is clear in paragraph three that
A. Tims wife paid for the children's education
B. Tim's children were yet to join school
C. Tim's children were in secondary school
D. Tim did not pay school fees for his children

34. When the robbers struck, Tim
A. had not withdrawn any money
B. had withdrawn some money
C. was on his way home
D. was outside the banking hall

35. The bank robbers, according to the passage
A. were all huge men
B. were all armed with rifles
C. were not all marked
D. all shot in the air

36. How many clients were in the bank?
A. ten people
B. about ten people
C. many but less than a hundred
D. over a hundred people

37. The robbers mission was accomplished
A. with a lot of confusion
B. in record time
C. after taking Tim's card
D. with death and destruction

38. What would be the best title for the passage
A. Tim's salary
B. A harrowing experience
C. Regency printers
D. Tim and his colleagues

Read the passage below and answer questions 39 -50

Africa is billed as the last frontier in feeding the world. But even with its vast fertile lands, massive rivers and amenable climate, it is a food-deficient continent as opposed to a rich food exporter. Africa has gained the dubious reputation of a drought and hunger-stricken continent. Meteorologists regularly issue warnings that the climatic conditions for farming will become harsher, hence poorer harvests. That begs the question of our true standing in the looming severe food insecurity.

The once-predictable seasons are changing and the future of food security in Kenya is bleak.

The Intergovernmental Authority on Development (Igad) recently reported that Kenya is experiencing its worst drought in 38 years. The rainfall deficit would plunge the country into a crisis that could see food insecurity and malnutrition undermine the economy.

Officially, more than 10 million Kenyans are food-insecure, with a majority often relying on relief. Also, the majority of the population has no access to food in the right amounts and quality. Households incur huge food bills due to the increasing food prices, fuelling inflation.

Agriculture is the engine of economic growth and a valuable source of income for most Kenyans. USAID reports that about 75 per cent of Kenyans derive all or part of their livelihoods from the sector, accounting for 18 per cent of gross domestic product (GDP).

Sadly, the sector is shunned by financial institutions. Farmers are traditionally hugely underserved by most financial institutions, given the perceived risk associated with the business. Bank loans have strenuous conditions, locking the majority out of the credit system and forcing them to resort to bootstrap funding a mode of starting a business without external help or capital.

However, in the past decade, agriculture has seen an increased interest in boosting its productivity as public and private sector institutions recognise the sector as a promising investment that addresses a national challenge.

39. According to paragraph one. It's true to say that
- A. Africa should be producing enough food to feed the world
- B. Africa is the only place in the world with food
- C. Africa is a rich food exporter
- D. Africa's climate is harsh

40. Three of the following are true about Africa **except**
- A. the land is quite productive
- B. There are immense rivers
- C. It is a food-rich continent
- D. The climate is responsive

41. Paragraph three states that
- A. Kenya faces serious challenges on food security in future
- B. Kenya's food security is rosy
- C. Kenya's food security will improve in future
- D. Kenya's food security will be predictable

42. Kenya's rainfall deficit will have the following outcomes
- A. food insecurity
- B. food insecurity and malnutrition
- C. Insecurity and proper nutrition
- D. food security and proper nutrition

43. After how long did Kenya experience its worst drought
- A. about a century ago
- B. about half a century ago
- C. about two decades ago
- D. about four decades ago

44. How many Kenyans are food insecure according to the passage
- A. ten million Kenyans
- B. more than five million Kenyans
- C. less than ten million Kenyans
- D. at least ten million Kenyans

45. For Kenya to do well economically, it has to
- A. buy more food abroad
- B. improve and support agriculture
- C. ask Kenyans to eat less
- D. use less money in buying food

46. According to USAID reports
- A. a minority of Kenyans depend on Agriculture
- B. only 18 per cent of Kenyans do not depend on Agriculture
- C. majority of Kenyans are dependent on Agriculture
- D. only 25 per cent of Kenyans are dependent on Agriculture

47. The word shunned as used in the passage means
- A. avoided
- B. assisted
- C. supported
- D. aided

48. Financial institutions
- A. offer many loans to farmers
- B. think it's too risky to offer farmers loans
- C. offer no loans at all to farmers
- D. offer flexible credit terms to farmers

49. The national challenge mentioned in the last paragraph is
- A. lack of credit from banks
- B. food insecurity
- C. population growth
- D. climate change

50. The **best** title for this passage would be
- A. Effect of famine
- B. Financial institutions
- C. Improving agriculture to spur economic growth
- D. Small scale farmers

SCHOOL BASED EVALUATION TEST

STANDARD SEVEN - YEAR 2019

(7)

COMPOSITION

STEP FLYER 006

Time: 40 minutes

SECTION B: COMPOSITION

YOUR NAME	
NAME OF YOUR SCHOOL	

Write composition with the following heading. Make your story as interesting as you can.

A WEDDING I ATTENDED.

JARIBIO LA MTIHANI

DARASA LA SABA - MWAKA 2019

KISWAHILI:LUGHA

STEP FLYER 006

7

SEHEMU YA KWANZA :LUGHA *Muda: Saa 1 Dakika 40*

SOMA MAAGIZO HAYA KWA MAKINI

1. Umepewa kijikaratasi hiki cha maswali na karatasi ya majibu. Kijikaratasi hiki kina maswali 50.
2. Katika karatasi ya majibu hakikisha umeandika:-
   (i) Jina lako *(ii) Jina la shule yako*

Kamilisha kifungu hiki kw akujaza nafasi kwa kuchagua kiteuzi kifaacho.

Hati nadhifu ni hati safi. Ni mwandiko ___1___ na matatizo ___2___. Herufi ___3___ hutakiwa kuwa sawa. kuna herufi za kuweka vitone; ni___4___ vitone hivyo viwepo. Kama ni herufi___5___ kukunjwa chini au juu ya msitari ___6___kukunjwa. Baadhi ya herufi huwa na vistari juu, kwa ___7___, vistari hivyo hupaswa kuwekwa. Mwandiko unatakiwa uwe ___8___ wastani ___9___ mkubwa sana ___10___ mdogo sana, usomeke vilivyo. Haifai kuka___11___ au kufutafuta kazi iliyoandikwa. Mwandiko___12___ unavutia na ___13___ machoni hata kabla ya mtu kukisoma ___14___ kilichoandikwa. Jifunze kuandika ___15___.

1.	A. isiyo	B. yasiyo	C. usio	D. usiwo
2.	A. lolote	B. zozote	C. yoyote	D. yeyote
3.	A.yote	B. zote	C. wote	D. lote
4.	A. nzuri	B. vizuri	C. uzuri	D. zuri
5.	A. za	B. la	C. ya	D. kwa
6.	A. kunafaa	B. linafaa	C. zinafaa	D. tunafaa
7.	A. hilo	B. hapo	C. hiyo	D. hivyo
8.	A. kwa	B. ya	C. wa	D. na
9.	A. isiwe	B. kusiwe	C. zisiwe	D. usiwe
10.	A. tena	B.pengine	C. zaidi	D. au
11.	A.katakata	B.takata	C. kutakasa	D. takataka
12.	A. nzuri	B. zuri	C. mizuri	D. mzuri
13.	A. kupendeza	B.kupendwa	C. kupendesa	D. kupendea
14.	A. hiki	B. hilo	C. kile	D. hiyo
15.	A.mzuri	B. bora	C. viema	D. vyema

Tegua kitendawili hii:.

16. Ndege wengi baharini

A. jua B. nyota

C. gari D. meza

17. Umbo hili utaliitaje?

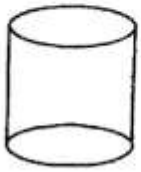

A. tufe B. maraba

C. mche D. mstatili

18. Tunasema biwi la simanzi, pia tunasema _____la moshi.

A. wingu B. mtungo

C. mvuke D. mkuroro

19. Katika kamusi, neno la tatu litakuwa lipi?

A. landa B. lafudhi

C. lahani D. laiki

20. Mchele, mawele na wimbi ni nafaka ilhali ng'ombe, mbuzi, kondoo na nguruwe ni

A. hombwe B. ombwe

C. hongwe D. howa

21. Shuka ni teremka. Shuka pia ni:

A. kifaa cha kukatia hasa miti

B. kitambaa kinachotandikwa kitandani

C. ndege mkubwa mwenye mbawa za kahawia

D. mnazi mchanga unaochomoza

22. Katika uwakifishaji, sauti (') huitwaje?

A. kituo B. kipumuo

C. king'ong'o D. hisi

23. Majina haya ni ya ngeli gani? Maji, mafuta, maisha, manukato

A. YA - YA B. U - ZI

C. U - YA D. MA - MA

24. Gari la majangili liliegeshwa_____njia.

A. kando mwa B. kando ya

C. kando kwa D. kando na

25. Nahau, piga mafamba haina maana ya

A. kumzandiki mtu

B. kumlaghai mtu

C. kumghilibu mtu

D. kumsema mtu

26. Mshororo wa tatu katika shairi la tarbia huitwa

A. mloto B. mleo

C. tathlitha D. utao

27. Wachezaji wanane kwa tisa ndio huitwa

A. thumuni tisa

B. tusui nane

C. thumuni nane

D. themanini na tisa

28. **Kanusha sentensi hii**

Akinipiga nitalia

A. kama hatanipiga sitalia

B. asiponipiga nitalia

C. akinipiga sitalia

D. asiponipiga sitalia

29. Ni nomino ipi isiyostahiki katika orodha ifuatayo?

A. mtu B. mvulana

C. daktari D. juma

30. Kutokana na kitenzi **"andika"** hatupati nomino

A. mwandishi B. kuandikika

C. uandishi D. mwandiko

Soma kifungu kifuatacho kisha ujibu maswali kuanzia 31 hadi 40.

Dalili za mvua ni mawingu. Baada ya kiangazi cha miezi tandatu, hatimaye mawingu yalitana angani. Wakulima walijawa na furaha kwa tumaini la kupata afueni ya mazao. Kila mtu alionekana shambani akiwa na jembe mkononi kwa kwamini kuwa achanikaye kwenye mpini hafi njaa.

Hatimaye jioni moja, kiza kiligubika nchi ikawa kama chumba kilichozimwa taa. Kwa ghafla mimweko na mingurumo ya radi ilisikika na kufuatwa na matone mazito yaliyosikika kwenye mapaa ya nyumba kijijini. Watu waliimba nyimbo za kumshukuru. Jalali kwa kuwajaalia mvua pamoja na kutoa dua za kushukuru.

Usiku ule mvua ilinyesha kwa makeke na upepo uliangusha miti na hata kubomoa nyumba zilizokuwa hafifu. Vifijo, hoi na nderemo viligeuka kuwa kwikwi za vilio kwa kupoteza mali na makao.

Mvua iliendelea kunyesha kidindia, siku zikaunda majuma ambayo hayakuchelewa kukomaa na kuunda miezi. Kama kwamba Mungu alifungulia biluli akasahau, mvua ilinyesha kwa miezi takribani minane bila kupungua. Si wahenga walisema kuwa hakuna kapa isiyokuwa na usubi? Mito ilifurika, barabara zikaharibika, mashamba yakageuka kuwa vinamasoi huku watu wengi wakikosa makao.

Hewaa! Baada ya kisa mkasa. Ati hakuna msiba usiokuwa na mwenziwe. Katika hali ya sitaifahamu, mvua ilisababisha mlipuko wa maradhi mbalimbali. Wenye kipindupindu walitibiwa huku waliokuwa na homa ya matumbo wakipewa ushauri na walioumwa na mbu wakishughulikiwa kunako zahanati za muda. Hali hii haikukoma hata baada ya miezi minane mvua ilipopusa.

Si wenye ndimi za kihenga waliamba kuwa aisifuye mvua imemnyea?

---

31. Kiangazi cha miezi tandatu ndicho kipi?
A. Miezi ya kutanda kwa mawingu
B. Miezi sita
C. Miezi ya kutanda mvua
D. Miezi saba

32. Mvua inayozungumziwa iliwapa nini wakulima?
A. ukosefu wa sehemu za kujisetiri
B. wasiwasi wa kupoteza makao yao
C. wahaka kuhusu mafuriko
D. tumaini na afueni ya mazao

33. Mbona mwandishi anamithilisha dunia na chumba kilichozimwa taa?
A. ilivyokuwa anga baada ya mawingu kutanda
B. ilivyokuwa hali baada ya umeme kupotea
C. baada ya upepo mkali kuzizima taa vyumbani
D. baada ya vyumba kukosa mwangaza

34. Kwa mujibu wa aya ya pili, ni kipi kilichokuwa cha mwisho?
A. Matone ya mvua
B. mingurumo ya radi
C. mimweko ya umeme
D. giza kufunika nchi

35. Iliponyesha mvua usiku wa kwanza, watu walifanya yote ila
A. kushukuru B. kukashifu
C. kupiga dua D. kushangilia

36. Mvua inayonyesha kidindia ndiyo inayonyesha vipi?
A. kwa wingi
B. bila kukoma
C. bila baridi
D. na upepo mkali

37. Mvua inayosemwa ilinyesha kwa muda gani?
A. Thuluthi mbili za mwaka
B. Thumni mbili za mwaka
C. Robo tatu za maka
D. Sudusi tatu za mwaka

38. Kwa mujibu wa aya ya nne, ni mambo mangapi ambayo yalitokea?
A. Matatu B. Manne
C. Matano D. Mengi

39. Kulingana na kifungu maradhi yaliyozuka hayakuwa pamoja na?
A. Malaria B. Kichocho
C. Waba D. Homa ya matumbo

40. Kipe kifungu hiki kichwa mwafaka
A. Maji ni uhai
B. Na ije baa iondoke baa
C. Hakuna kapa isiyokuwa na usubi
D. Aisifuye mvua imemnyea

Soma kifungu kifuatacho kisha ujibu maswali kuanzia 41 hadi 50.

Kunguru aliugua maradhi mabaya kwa muda mrefu. Alikonda sana. Hakuwa na nguvu za kutafuta chakula. Njaa ilimuuma si haba. Hakujua jinsi ya kutafuta chakula kwani ubongo wake haungefikiria vizuri.

Nyumbani kwake kulikuwa na nyasi nyingi sana ndefu. Huko kulijaa panzi lakini kunguru nangeweza kuwadona kwa sababu walitoroka. Panzi walimcheka kunguru mnyonge kwa!kwa!kwa! kunguru alipokuwa akitembea siku moja aliwaona panzi wawili wakipigana kufa na kupona. Baadaye waliaga dunia, baada ya kuumizana na kupata majeraha mabaya sana.

Kunguru alitoka pahali alikuwa na kuwadona. Aliwala, walikuwa watamu ajabu. Alijaribu kutafuta panzi wengine waliokuwa wamekufa kwa sababu hakushiba. Hakufanikiwa hata kidogo.

Aliamua kuwachochea panzi, alitumia panzi moja mlafi kwa kumdanganya ati alikulia nyasi mbovu ilh Ji wengine walikuwa nyasi nzuri. Panzi mlafi alienda na akaanza kutoa fujo kwa panzi wengine. Vita vilizuka baina ya panzi. Kunguru alikuwa mbali akicheka na kusema, "Wajinga ndio waliwao."

Panzi wengi walikufa sana kutokana na vita vile, karibu wamalizane. Kunguru alizidi kuchochea panzi kuuana aijifanya rafiki aliyekuwa na hofu zaidi. Baada ya panzi wengi kufa, waliamua kumaliza vita ili wasimalizane. Baada ya vita, kunguru alionekana akiwala mizogo wa panzi waliokufa kwa furaha sana. Panzi walipoona hivyo walijua kunguru ni mwongo.

---

41. Kunguru alikonda kwa nini
A. aliugua muda mrefu
B. hakutaka kula
C. hakuwa na hamu ya kula
D. hakukuwa na panzi

42. Kwa nini kunguru hakujua jinsi ya kupata chakula?
A. Aliatafuta panzi
B. Alikuwa peke yake
C. Ubongo wake haungefikiria vizuri
D. Panzi hawakufa

43. Kwa nini kunguru alitamani kuwala panzi wengine
A. Panzi walikufa zaidi
B. Ni watamu sana
C. Hakushiba
D. Ili awe na nguvu

44. Kunguru alipowatafuta panzi wengine
A. hakuwapata
B. aliwapata
C. alichoka
D. walitoroka

45. Kisawe cha neno maradhi ni
A. ugonjwa B. afya
C. njaa D. unyonge

46. Kusema vita vilizuka ni kusema kwamba
A. vita viliendelea
B. vita vilianza
C. vita vilikoma
D. vita vilimalizwa

47. Mnyama akiaga huitwa mzoga, je binadamu akiaga huitwa?
A. Mzoga B. Mtú
C. Maiti D. Jeneza

48. Kunguru alitumia mbinu gani kupata chakula?
A. Kutafuta panzi waliokufa
B. Alichochea vita kwa panzi
C. Alienda hospitalini
D. Aliwinda panzi na akala nyasi

49. Panzi waliamua kumaliza vita wakati gani?
A. Walipochoka kupiga
B. kunguru alipowacheka
C. walipouana sana
D. walipojua ulikuwa uwongo wa kunguru

50. Kichwa kifaacho habari hii ni
A. vita vya panzi furaha ya kunguru
B. Uongo wa kunguru
C. panzi watamu
D. kunguru mgonjwa

JARIBIO LA MTIHANI

DARASA LA SABA - MWAKA 2019

INSHA

STEP FLYER 006

7

SEHEMU YA PILI: INSHA *MUDA: Dakika 40*

JINA LAKO	
JINA LA SHULE YAKO	

Endeleza insha hii

Asubuhi hiyo siku ya jumatatu tulipokuwa gwarideni, mwalimu mkuu.....

SCHOOL BASED EVALUATION TEST

STANDARD SEVEN - YEAR 2019

STEP FLYER 006

MATHEMATICS

7

Time : 2 Hours

READ THESE INSTRUCTIONS CAREFULLY.

1. You have been given this question paper and a separate answer sheet. The question paper contains 50 questions.

2. Make sure that you have written on the answer sheet.

(i) Your name *(ii) Name of your school*

1. Which of the following is ninety two thousand seven hundred fifty seven and fourteen thousandths

A. 92757.14 B. 92757.014

C. 9275714 D. 927571400

2. What is the value of digit 6 in 7610315

A. hundred thousands

B. six hundred thousand

C. millions

D. tens of thousands

3. What must be multiplied by 0.07 to get 7

A. 100 B. 10

C. 0.1 D. 0.01

4. What is the sum of the next two missing numbers

1,3,6,10,15____

A. 21 B. 28

C. 49 D. 7

5. What is the value of

$^3/_5 + {}^1/_3$ of $(^4/_7 - {}^1/_5) \div {}^2/_3$

A. $2^3/_{10}$ B. $^{11}/_{14}$

C. $5^1/_5$ D. $1^3/_{10}$

6. If a=3, b=a -1 and c = b + 4

Evaluate

$$\frac{a^2 + c}{2b - 1}$$

A. 5 B. 3

C. 7 D. 1

7. Jared deposited sh 24000 in a bank which pays 15% simple interest. He withdrew all the interest after $1^1/_2$ years. How much money did he withdrew

A. Sh 4040 B. Sh 3600

C. Sh 5400 D. Sh 2940

8. James fenced his rectangular piece of land measuring 50m by 25m. Using five strands of wire what length of wire did he use

A. 750m B. 600m

C. 375m D. 150m

9. What is the next number in the sequence below

$^1/_2$, $^5/_8$, $^3/_4$, $^7/_8$

A. 2 B. $1^1/_8$

C. $1^1/_7$ D. 1

10. What is the value of 8.229 ÷ 4 correct to the nearest thousandths

A. 2.058 B. 2.0573

C. 2.573 D. 2.057

11. Mwangi drives $2^1/_2$ hrs at an average speed of 64km/h and later drives 50km at 100km/h. What is his average speed for the whole journey

A. 50km/h B. 70km/h

C. 3km/h D. 210km/h

12. Mkulima bought a radio cassette on hire purchase terms. He paid a deposit of sh 5000 and there after 15 monthly installments of Sh 1200 each. If the total amount he paid was Sh 3000 more than the marked price, what was the marked price of the radio cassette

A. Sh 23000 B. Sh 13000

C.Sh 26000 D. Sh 20000

13. Find the perimeter of the shape below in metres

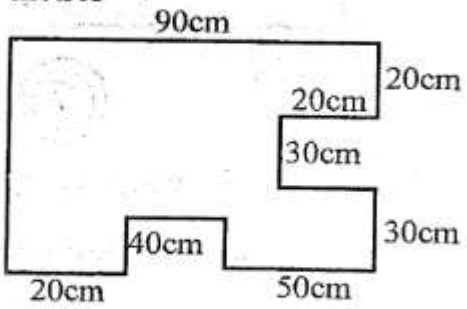

A. 460mm B. 300cm
C. 4.6m D. 52m

14. Elijah scored an average mark of 63% in six tests in the first five, his score was 67%, 58%, 72%, 53% and 60%. What was his score in the sixth test?

A. 378 B. 69
C. 68 D. 75.6

15. Nyambura bought the following items from a shop.

2kg of flour for sh 150
3kg of rice @ sh 70
2 bars of soap @ sh 110
2kg of cooking fat @ sh 100
2boxes of matches for sh 10

If she gave the shopkeeper sh 1000 note, how much balance did she receive

A. Sh 50 B. Sh 210
C. Sh 950 D. Sh 790

16. What is the sum of the next two prime numbers after 83

A. 172 B. 186
C. 170 D. 176

17. In the figure below angle BAC is 52° and angle ACB is 48°. Find the measure of angle t

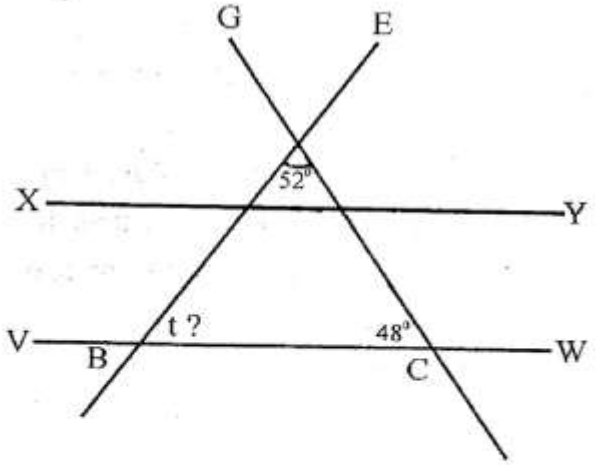

A 100° B. 80°
C. 48° D. 52°

18. Which of the following measurements will form a right angled triangle

A. 7cm, 8cm, 10cm
B. 2.5cm, 6cm, 6.5cm
C. 4cm, 6cm, 10cm
D. 5cm, 6cm, 7cm

19. An orange tree was 160cm. The height of the tree increased by $7^1/_2$ find the new height of the orange tree

A. $267^1/_2$cm B. $107^1/_2$cm
C. 172cm D. 167cm

20. Five men working at the same rate can dig a shamba in 12 days. How many days will 15 men take

A. 4 days B. 60 days
C. 27 days D. 17 days

21. 5(7 - 3e) + 3 (9e + 2)

A. 12e + 41 B. 12e - 41
C. 42e - 2a D. 42e = 2a

22. Find the perimeter of the given figure below (take pie to be $\pi = 3\frac{1}{7}$)

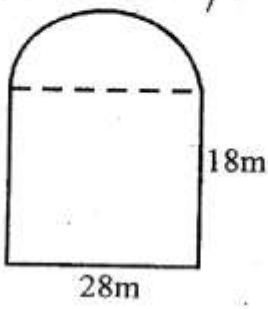

A. 108m B. 90m
C. 80m D. 108m²

23. King'ong'o and Muriasi shared sh 750 in the ratio of 7:8 respectively how much Muriasi get

A. Sh 500 B. Sh 400
C. Sh 250 D. Sh 350

24. The price of a radio was reduced by 20% in a reduction sale. If maina bought it at Sh 5600, what was the original price of the radio

A. Sh 1400 B. Sh 7000
C. Sh 6000 D. Sh 8000

25. The mean weight of 8 chicken is $3^1/_2$kg. The total weight of three of the chicken is 13kg what is the mean weight of the remaining five chicken in grammes

A. 3000 B. 8

C. 28 D. 3

26. The area of a triangle is 96cm². If its base is 12cm what is the height of the triangle

A. 16cm B. 32cm

C. 24cm D. 12cm

27. What is the value of

$$\frac{0.48 \times 0.24}{0.24 \times 0.06}$$

A. 8 B. 800

C. 0.8 D. 80

28. The table below shows the number of goats sold in a week

Day	Mon	Tue	Wed	Thur	Fri
No sold	43	40	39	46	42

What was the median number of goats sold

A. 41 B. 43

C. 42 D. 39

29. The charges for sending a telegram are sh 12 for ten words or less. Sh 1.00 is paid for each extra work. A tax of 18% of the total is then charged. How much did Sophia pay to the nearest five cents for the telegram below

JOSHUA BOX 18 KANGUNDO SEND SCHOOL FEES SHILLINGS TWELVE THOUSANDS JOSHUA

A. Sh 15.34 B. Sh 15.30

C. Sh 15.50 D. Sh 15.35

30. A pick up carried 14 cartons. Each carton had 200 tins. What is the total mass of the tins in tonnes if each tin was 500g

A. 14 B. 14000

C. 1.4 D. 1400

31. The ration of sheep to cows in a flock is 5:3. If there are 130 less cows than sheep. How many cows are in the flock

A. 390 B. 520

C. 325 D. 195

32. On a map the scale used is 1:5000. A piece of land is drepresented on a drawing by a length of 3cm by 2cm. Find the actual area of the land in hectares

A. 6ha B. 1.5ha

C. 300ha D. 0.3ha

33. Find the size of the angle marked **L**

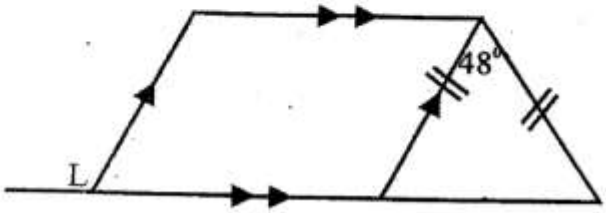

A. 114° B. 66°

C. 132° D. 48°

34. Tap A takes 6 hours to fill a tank while tap B takes 8 hours to fill the same tank. What fraction of the tank is filled by both taps in 1 hour

A. $^1/_{24}$ B. $^7/_{24}$

C. $^1/_8$ D. $^1/_6$

35. Which is the shortest length of wire from which equal pieces of length 32cm, 28cm and 36cm can be obtained without a remainder

A. 4cm B. 96cm

C. 2016cm D. 120cm

36. Work out

$(0.9)^2 + \sqrt{0.0196}$

A. 0.95 B. 0.14

C. 0.81 D. 0.95

37. Arrange the following ascending order

$^2/_3$, 0.42, $^5/_8$ and 0.44

A. 0.42, $^2/_3$, 0.44, $^5/_8$

B. 0.42, 0.44, $^5/_8$, $^2/_3$

C. $^2/_3$, $^5/_8$, 0.44, 0.42

D. 0.42, $^2/_3$, 0.44, $^5/_8$

38. Calculate the area of the closed cylinder shown below $\pi = \frac{22}{7}$

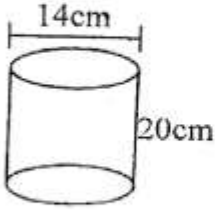

A. 1034cm²

B. 880cm²

C. 1188cm²

D. 308cm²

39. The table below gives the distance in kilometres between town F to K

F				
150	G			
195	80	H		
200	120	75	J	
320	240	90	40	K

What is the distance between town F and K via G

A. 150 B. 320
C. 240 D. 390

40. What is the value of
$(3y + 4b) - (2y + b)$
If $b=6$ and $y = 10$

A. 28 B. 80
C. 40 D. 54

41. Karanja bought 5.86kg of potatoes, Kamau bought half what Karanja bought and Omondi bought 3 times what Kamau bought. What was the total mass of the potatoes bought by the three people

A. 8.79 B. 14.65
C. 11.79 D. 17.58

42. What is twice the value of **w** in the figure below

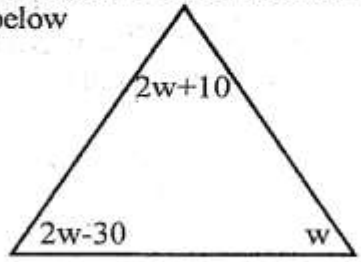

A. 40 B. 80 C. 50 D. 36

43. Three hundred and sixty four people contributed Sh 450 each to buy a piece of land. How much did they contribute all together

A. Sh 814 B. Sh 136800
C. Sh 163800 D. Sh 16380

44. What is the distance of the given figure below in metres

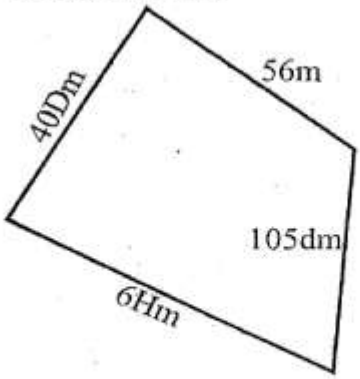

A. 10.665m B. 10665m
C. 1066.5m D. 106.65m

45. Wendy is **p** years old. Her father is 7 times as old as wendy. How old will her father be in 30 years time?

A. $7p + 30$ B. $8p + 60$
C. $2p + 30$ D. $p + 30$

46. A rectangular tank measures 3.2m by 12m by 4.5m high. Find the volume of the tank in cubic metres

A. $172.8m^3$ B. $172800m^3$
C. $1.728m^3$ D. $1728m^3$

47. Mwango visited her aunt on January 20th 2016. He went back home on 3rd March 2016. How many nights did she sleep at her aunt's place

A. 91 B. 44
C. 43 D. 42

48. Solve the inequality below

$$\frac{2x - 2}{2} > \frac{x + 3}{4}$$

A. $x > 1^2/_5$ B. $x > 2^1/_3$
C. $x < 1^2/_5$ D. $x < 2^1/_3$

49. Construct triangle PQR in which QP=6cm, PR=4.5cm and angle PRQ is 1200. Draw a circle that passes point PQR. What is the diameter of the circle?

A. 6.8cm B. 10.6cm
C. 3.4cm D. 5.3cm

50. ***The graph below shows Nyangweso's journey from Nyeri to Migori by car. He started his journey at 8.00 a.m and arrived at 3.30 p.m***

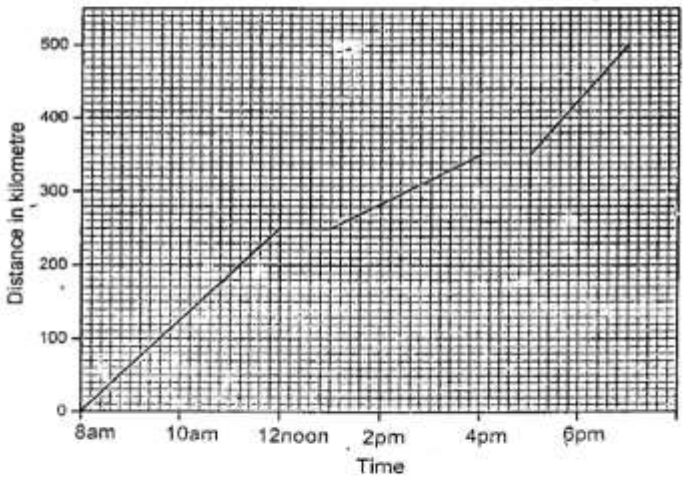

What was his average speed after lunch

A. 50km/h B. 150km/h
C. $66^2/_5$km/h D. $55^5/_9$km/h

SCHOOL BASED EVALUATION TEST

STANDARD SEVEN - YEAR 2019

STEP FLYER 006

SCIENCE

7

READ THESE INSTRUCTIONS CAREFULLY. *Time : 1 Hour 40 Mins*

1. You have been given this question paper and a separate answer sheet. The question paper contains 50 questions.
2. Make sure that you have written on the answer sheet.

1. Which of the following is **not** a way in which plants depend on animals?
   A. Decomposition B. Pollination
   C. Support D. Manure
2. Alice was walking near an air strip she noticed a wind sock pointing towards North. Which direction was the wind blowing from?
   A. South B. North
   C. West D. East
3. Which of the following type of teeth is **not** part of milk teeth?
   A. Premolar B. Canine
   C. Incisor D. Molars
4. Which of the following is **not** an example of rotational grazing?
   A. Strip grazing B. Herding
   C. Paddocking D. Tethering
5. Roughage in a diet helps in:
   A. constipation
   B. absorption of digested food
   C. removing digested matter
   D. emptying bowls
6. Digestion of food ends in the;
   A. large intestines B. ileum
   C. rectum D. anus
7. Which of the following food preservation methods are both modern and tradition?
   A. Drying and use of low temperature
   B. Drying and salting
   C. Canning and refrigeration
   D. Proper storage and drying
8. Which of the following is a health effect of drug abuse?
   A. Hallucination B. Truancy
   C. Accidents D. Rape
9. All the following are signs of ill health in livestock **except**
   A. rough coat B. coughing
   C. dry muzzle D. glossy coat
10. Which of the following is **not** an insectivorous plant?
    A. Butter worts B. Sundew
    C. Water lily D. Cobra lily
11. Which one of the following materials is opaque?
    A. Mirror B. Kerosene
    C. Skylight D. Oiled paper
12. All the following are factors that increase soil erosion **except**
    A. ploughing along contours
    B. slope
    C. human activities
    D. amount of rainfall
13. Std five pupils set up the experiment below.

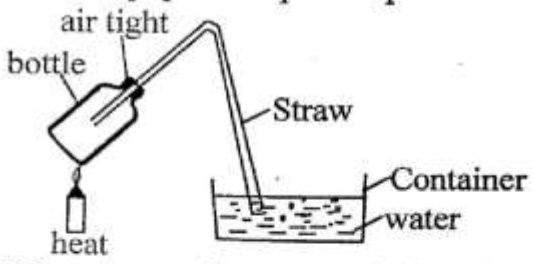

What observation was made from the experiment above?
A. Water level raised in the container
B. Water level dropped in the straw
C. Bubbles were seen in water
D. Bottle broke

14. Three of the following are properties of crops used to prepare green manure. Which one is **not**?
A. quick decay
B. slow growth
C. leafy crops
D. high nitrogen content

15. Which of the following plants can give us oil?
A. Cocoa B. Maize
C. Coffee D. Yams

16. Maize, rice and wheat are examples of:
A. cereals B. tubers
C. legume D. vegetables

17. Which part of a maize seed forms the embryo?
A. Endosperm and cotyledon
B. Testa and plumule
C. Scar and endosperm
D. Plumule and radicle

18. The experiment below was used by std 4 pupils. Where they put soil and water in bottle, shook it left it to settle down.

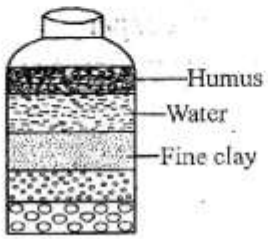

What caused the arrangement of the layers shown above?
A. type of soil B. humus
C. density D. mass

19. Drenching is a method of controlling livestock parasites. Which parasite below can not be controlled by drenching?
A. tick B. liverfluke
C. tapeworms D. roundworms

20. Which one of the following processes require loss of heat to the environment?
A. Freezing B. Evaporation
C. Melting D. Boiling

21. Std four pupils performed the experiment below.

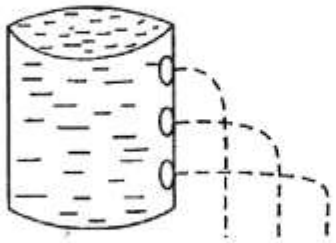

Which one of the following materials was **not** needed for the experiment above?
A. a nail B. clay
C. tin lid D. tin can

22. All the following are organic fertilizers **except** one. Which one is it?
A. Farmyard manure
B. Muriate of potash
C. Green manure
D. Organic mulches

23. The chart below shows classification of plants

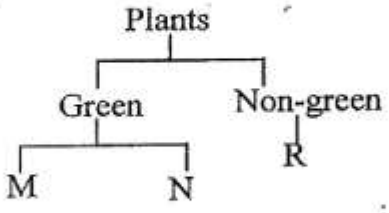

Name the plants named M, N and R

	M	N	R
A.	Maize	toad stool	beans
B.	onion	algae	mushrooms
C.	cypress	yeast	moulds
D.	sugarcane	cactus	pine

24. Which one of the following group contains the foods that promotes body immunity?
A. Eggs, milk, beans
B. Maize, wheat, rice
C. Yams, sugarcane, omena
D. Lemon, cabbage, carrot

25. What happens to a lizard when it busk in the sun?
A. Its temperature rises
B. Its body temperature remain constants
C. Its body temperature drops
D. It expands

26. Which method of rotational grazing is practiced only with few number of animals?
A. Strip grazing
B. Paddocking
C. Tethering
D. Zero grazing

27. Std 5 pupils classified animals as shown below.

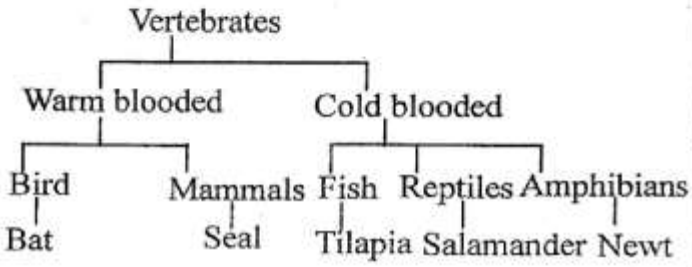

Which animals were wrongly classified?
A. Seal, newt
B. Bat, salamander
C. Bat, seal
D. Seal, salamander

28. Which one of the following is **not** part of the non-living environment?
A. Plants. B. Soil
C. Water D. Air

29. All the following are ways of maintaining simple tools, which one is **not**?
A. Sharpening
B. Cleaning after use
C. Oiling and greasing
D. Fiting handle with insulators

30. When constructing a beam balance the hole you make for the pivot should be:
A. very wide
B. very small
C. at the balancing point
D. on the base

31. Magnetic force is measured in:
A. beam balance
B. spring balance
C. kilograms
D. newtons

32. Which statement below is true about all medicines?
A. All medicines are drugs
B. All medicines cause stimulation
C. All medicine cure diseases
D. All medicines are made from plants

33. Which one of the following is formed when ova fuses with sperm?
A. Ovary B. Zygote
C. Embryo D. Sex cell

34. Which one of the following is **not** a myth about HIV and AIDS?
A. AIDS is a curse from God
B. Witchcraft can cure AIDS
C. AIDS has no vaccine
D. Mosquito can transmit HIV

35. Tick feeds by;
A. chewing B. sucking
C. butting D. nibbing

36. The experiment below was used by std 6 pupils.

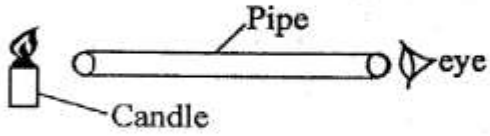

What conclusion can be made from the set up?
A. Candle produce heat and light
B. Light can be reflected
C. Light can be refracted
D. Light travel in a straight line

37. Which one of the following statement is not true about one kg of salt and one kg of feathers?
A. 1kg of feather has more volume than 1 kg of salt
B. They have equal masses
C. 1kg of salt has more mass than 1kg of feathers
D. They have different volumes but equal masses

38. The following are signs of certain illnesses
(i) fever
(ii) pain in joints
(iii) blood in stool and urine
(iv) pain in the chest
(v) fatigue and dizziness
Which symptoms above are for malaria?
A. ii and iii B. i and ii
C. ii and iv D. i and v

39. When breathing in air is warmed by:
A. mucus B. hour
C. blood capillaries D. lungs

40. The diagram below shows the human heart



Which heart chamber marked above gets poison last when a snake bite you?
A. M B. R
C. N D. O

41. What is the role of finger like projections in the human digestive system
A. produce digestive juice
B. increase the surface area for food digestion
C. store undigested food
D. facilitate absorption of digested food

42. BCG is administered at the age of:
A. at birth B. 6 weeks
C. 9 months D. 14 weeks

43. Which one of the following is **not** a source of current electricity?
A. Batteries B. Bicycle dynamo
C. Dam D. Generator

44. Std 5 pupils set up the experiment below to investigate heat transfer.

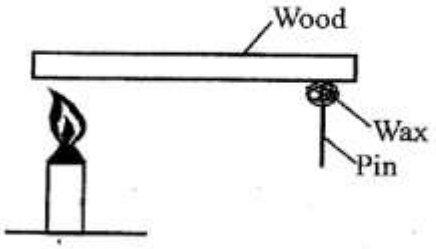

After some minute pin fell, what made the wax to melt?
A. conduction B. radiation
C. convection D. evaporation

45. Digestion of oils takes place in the:
A. duodenum B. small intestines
C. mouth D. stomach

46. Which one of the following is **not** a function of plasma?
A. Transport digested food
B. Transports carbon dioxide
C. transport oxygen
D. transport heat in the body

47. Which method of separating mixture leads to recovery of one substance only?
A. Evaporation B. Filtering
C. Picking D. use of magnet

48. Which one of the following is **not** a good conductor of electricity?
A. Copper B. Graphite
C. Carbon rod D. Glassrod

49. The following are safety precaution against lightnening. Which one is **not**?
A. Fiting lightening arrester on building
B. Avoid walking on pools of water
C. Wear rubber soled shoes
D. Avoid inserting objects in sockets

50. The two gases in the air that makes 99% when combined are
A. oxygen and carbon dioxide
B. Nitrogen and oxygen
C. Nitrogen and carbondioxide
D. oxygen and innert gases

SCHOOL BASED EVALUATION TEST

STANDARD SEVEN- YEAR 2019

006 SOCIAL STUDIES & CRE

7

READ THESE INSTRUCTIONS CAREFULLY. **TIME: 2hrs 15mins**

1. You have been given this question paper and a separate answer sheet. The question paper contains 90 questions.
2. Make sure that you have written on the answer sheet.
   (i) Your name *(ii) Name of your school*

Study the map of Mawe area and use it to answer questions 1 - 7

MAWE AREA

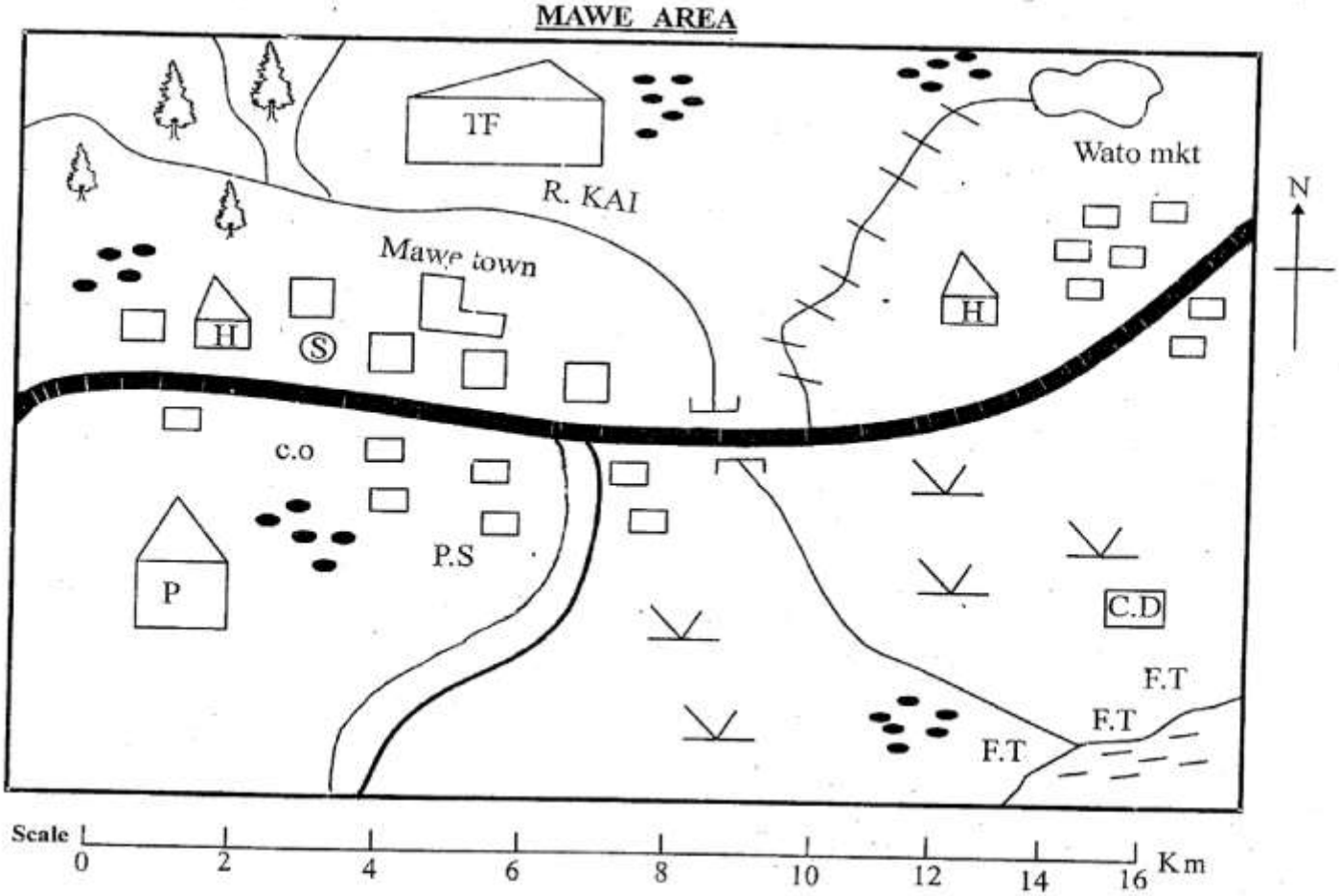

Scale 0 2 4 6 8 10 12 14 16 Km

KEY

Forest	Scrubs	Temple	Railway line
T.F - Tea factory	C.D - Cattle dip	P.S -Police Station Lake	Tarmac road
School	FT - Fish trap S - Station	Quarry	River and bridge
Huts	C.O - County office	Permanent buildings	Posho mill

1. The general direction of flows of River Kai is towards
   A. North West B. South East
   C. North East D. South West
2. Mawe area is administred by a
   A. County commissioner
   B. Sub country commissioner
   C. Governor
   D. County representative
3. Population distribution at Mawe area has been influenced by
   A. transport and communication
   B. drainage
   C. economic activities
   D. presence of security
4. Which one of the following services is offered in Mawe area?
   A. Health B. Recreation
   C. Theatre D. Education
5. Which one of the following industries is likely to be found in Mawe area?
   A. Manufacturing industry
   B. Processing industry
   C. Service industry
   D. Assembling industry
6. The **main** economic activity in mawe area is
   A. fishing B. trading
   C. mining D. maize growing
7. Which religion is practised in mawe area
   A. Hinduism B. Islamic
   C. Christianity D. Traditionalism
8. Which one of the following is a negative impact of rapid population growth on resources?
   A. Increased labour force
   B. Improved health care
   C. Pressure on the existing social service
   D. Availability of employment opportunities
9. The council of elder among the Ameru that handles difficult cases was
   A. Kiama B. Njuri Ncheke
   C. Nkomango D. Njuri impere
10. The following is a description of a certain type of vegetation
   (i) tall and evergreen trees
   (ii) trees have straight trunks and buttress roots
   (iii) Forests have very little undergrowth
   Which vegetation type is described above
   A. Savannah vegetation
   B. Equatorial vegetation
   C. Swamp vegetation
   D. Mediterranean vegetation
11. Which one of the following is a service industry?
   A. Textile industry B. Ginnery
   C. Dry cleaning D. Posho mill
12. The following countries are crossed by Trans saharan highway **except**?
   A. Nigeria B. Algeria
   C. Niger D. Mali

Use the map of Africa below to answer questions 13 to 16.



13. The relief feature marked **B** was formed through
   A. folding
   B. faulting and uplifting
   C. volcanicity
   D. denudation
14. The multi purpose project marked **C** was mainly constructed to
   A. control floods
   B. provide water for irrigation
   C. provide cheap power
   D. establish fishing grounds
15. Three of the following statements are true about the climatic region marked **Y**. Which one is **not**?
   A. Rainfall is experienced mainly during winter
   B. Rainfall is accompanied by lighting and thunderstorms
   C. The hottest months in the year are march and september
   D. The type of rainfall received is mainly convectional
16. The lake formed **E** was formed through
   A. faulting B. downwarping
   C. erosion D. deposition
17. Which one of the following early visitors was a trader?
   A. Vasco da Gama
   B. David livingstone
   C. Henry Morton stanley
   D. William Mackinnon

18. The following communities collaborated with European colonial rule except
A. Kandinka B. Lozi
C. Ibowanga D. Maasai

19. Which one of the following is the **main** tourist attraction in Egypt?
A. Wildlife B. Historical sites
C. Sandy beaches D. Cultural activities

20. The main reason for the establishment of East African community was to
A. reduce trade barriers
B. improve transport in the area
C. widen markets for goods produced
D. introduce a common currency

21. The weather instrument drawn below is used to measure

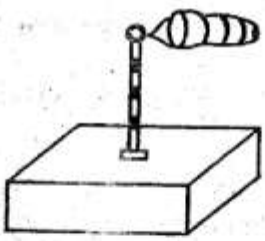

A. amount of rainfall
B. hotness or coldness of a place
C. air pressure
D. strength of wind

22. Which one of the following plain nilotes are found in Uganda?
A. Karamajong, Iteso, Jie
B. Toposa, Murle, Azande
C. Maasai, Burji, Samburu
D. Nandi, Iteso, Sabaot

23. The **main** cause of accident in most Kenya roads is
A. driving unroadworthy vehicles
B. overloading vehicles
C. negligence of road user
D. following traffic rule

24. Which one of the following is the **cheapest** methods of preserving fish
A. canning B. sun drying
C. salting D. refrigeration

25. Which one of the following is economic right?
A. Right to vote
B. Right to privacy
C. Right to food
D. Right to be paid well

26. The act of taking over the responsibilities and property of a deceased person is called
A. a will B. succession
C. administration D. acquisition

27. The following are ways of demonstrating patriotism in Kenya **except**
A. payment of taxes
B. conserving environment
C. promoting human rights
D. engaging in corruption

28. The **main** problem facing tourism in Africa is
A. poor marketing strategies
B. political instability
C. insecurity
D. similarity of tourist attraction

29. Below is a description of a certain early visitor
(i) was both a missionary and explorer
(ii) sent by royal geographical society
(iii) did his missionary work in central Africa
(iv) fought against slave trade
The early described above as
A. Henry Morton Stanley
B. Dr David Livingstone
C. Johannes Rebman
D. John Krapt

30. Which one of the following fish is caught in marine fishing grounds?
A. Mackerel B. Salmon
C. Trout D. Black bass

31. The following factors limit peace in the society. Which one is **not**?
A. Bad leadership
B. Political differenceof human rightsleadership
D. Transpareney

32. The dispersal point of the River Lake nilotes was at
A. Mt Elgon
B. Shungwaya
C. Pukungu Pakwach
D. Southern Sudan

33. The time at town W 40°E is 9.00 a.m. What is the time at town Y 13°W?
A. 11:32am B. 5:28am
C. 7:12am D. 10:48am

34. The **main** pastoral community in West Africa is the
A. Fulani B. Tuaregs
C. Tswana D. Maasai

35. The road sign below indicates



A. drive with caution
B. bumps ahead
C. road junction
D. give way

36. Which one of the following is a way the communities may contribute to school development?
A. Promote the culture of the communities
B. Guides pupils to obey laws of the land
C. Offer labour to the school
D. Help learners discover their talents

37. The earliest inhabitants in central Africa is
A. Bantus B. Bambuti
C. Boers D. Arabs

38. The **main** problem facing forestry in the Democratic republic of Congo is
A. Forest fires
B. Poor harvesting techniques
C. Human encroachment
D. Pest and diseases

39. The following countries are crossed by the equator **except**
A. Gabon B. Uganda
C. Dr Congo D. Cameroon

40. Forests in Africa are mainly influenced by
A. drainage B. rainfall
C. soil fertility D. altitude

41. The type of wind found at the side marked A are

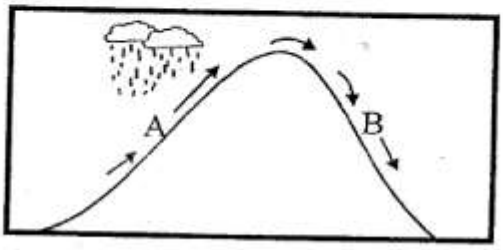

A. cool and wet
B. hot and dry
C. cool and dry
D. warm and moist

42. The above rainfall is experienced in the following areas **except**
A. Musoma B. Kitale
C. Embu D. Arusha

43. Which one of the following lakes were formed through erosion?
A. Wum, Nyos, Paradise
B. Tana, Catherine, Tana
C. Teleki, Maghra, Gallery
D. Kivu, Magadi, Jipe

44. The **main** cause of soil erosion at the Northern part of Kenya is
A. deforestation B. overstocking
C. heavy rainfall D. mono cropping

45. Which one of the following minerals is correctly matched with the end product
A. Flourspar - electric wires
B. Soda ash - cement
C. Datomite - filters
D. Limestone - salt

46. Which one of the following aspect of culture can be preserved?
A. Polygamy B. Witch craft
C. Polygamy D. Tradition medicine

47. Which one of the following factors should be considered first before establishing dairy farming?
A. The climatic conditions
B. The accesibility of the area
C. Availability of land
D. The type of diseases that may attack the cattle

48. The **main** problem facing multi purpose project in Africa is
A. prolonged drought
B. siltation of the dams
C. displacement of people
D. occurrence of diseases

49. The person incharge of election at the county level is
A. National returning officer
B. Presiding officer
C. Polling clerk
D. Returning officer

50. The highest court in Kenya is headed by the
A. judges B. attorney general
C. chief justice D. chief registrar

51. The traditional parliament of Swaziland is
A. Libandla B. Liqoqo
C. Tinkhudla D. Ngwenyama

52. The **best** form of communication used in mass media
A. television B. radio
C. newspaper D. magazine

53. In traditional African society education was passed through the following ways **except**
A. use of proverbs B. imitation
C. writing D. apprenticeship

54. The headquarters of old Ghana kingdom was located at
A. Wagadu B. Bissandugu
C. Kumbi saleh D. Walafa

55. Who among the following represent the county in the national assembly?
A. Women Representative
B. County representative
C. Governor
D. Speaker

56. Below are description of a certain prominent leader
(i) abolished ownership of slaves
(ii) founder member of OAU
(iii) introduced new constitution in his country
The leader described above is likely to be
A. Julius Nyereere
B. Haile Selassie
C. Gamal Abdel Nasser
D. Leopold Senghor

57. Most people in Africa prefer transporting goods using road **mainly** because
A. cheap to construct
B. faster than other forms of transport
C. it is the most spread
D. it is the cheapest

58. The following are ways through which **Seyyid said** used to increase volumes of trade in Eastern African coast **except**
A. Signing treaties
B. sending of trade caravans
C. inviting money lenders
D. becoming the Sultan

59. Which one of the following forms of democracy is practised in Kenya?
A. Representative B. Nominational
C. Liberal D. Participatory

60. In school staff meeting minutes are written by
A. Senior teacher
B. Deputy headteacher
C. Head teacher
D. Chairperson

CHRISTIAN RELIGIOUS EDUCATION.

61. According to the Bible story of creation, which one of the following is **not** a reason why God created a woman? To
A. be a companion to the man
B. work for man
C. be a helper to the man
D. have children with the man

62. When Abraham was called by God he was living in
A. Sinai B. Bethel
C. Haran D. Damascus

63. Which one of the following is the **main** reason why Moses left midian for Egypt?
A. He wanted to establish a new home
B. He was commanded by God
C. He wanted to talk to the Pharaah of Egypt
D. He wanted to visit the Israelites in Egypt

64. The **main** reason why Noah built an ark was to make him be able to
A. fulfill God's wish
B. worship God there
C. keep the animal
D. hide his family

65. Which one of the following was a practise of Israelites during Passover feast?
A. Drinking wine
B. Eating unleavened bread
C. Eating boiled meat
D. Reciting the ten commandment

66. Who among the following made a wrong choice?
A. Moses B. Joseph
C. Abraham D. Ananiah

67. Which one of the following is **not** a value taught in the sermon on the mount?
A. Poverty B. Humility
C. Injustice D. Purity

68. "Do not commit murder" Exodus 20:13. Two of the following people broke this commandment, who were they
A. Abel and Enoch
B. Noah and Solomon
C. Isaac and Naboth
D. Cain and David

69. The parable of Jesus which teaches us about the growth of the kingdom of heaven is
A. the sower
B. the mustard seed
C. the good samaritan
D. the lost son

70. Three of the following are gifts of the Holy spirit. Which one is **not**?
A. Wisdom B. Healing
C. Peace D. Faith

71. Which one of the following is **true** about Jesus teaching on prayer?
A. Prayer should be loud
B. Do not use many meaningless words
C. Pray while standing in street corners
D. When you pray close your eyes

72. Which one of the following events in the life of Jesus showed that He respected the tradition of the jews. When He
A. talked to the samaritan woman at the well
B. attended the passover feast at the age of twelve years
C. was tempted by the devil
D. fed the five thousand people

73. Which of the following is the meaning of being spiritually poor?
A. Not having wealth
B. Being a beggar
C. Being dependent on God
D. being very poor and not able to give offerings

74. Special gifts that God has given different people are called
A. blessings B. presents
C. talents D. prizes

75. The parable of the good samaritan teaches Christians that they should
A. travel in groups
B. help those in difficulties
C. avoid accidents
D. avoid lonely paths

76. Which one of the following happened on the day Jesus died?
A. There was a voice from heaven
B. Moses and Elijah appeared
C. There was an earthquake
D. Angels sang

77. "Remember me, Jesus when you come as king (Luke 23:42) who said these words? The
A. Roman thief B. Repentant thief
C. Simon of Cyrene D. Simon Peter

78. Who among the following people died because of cheating the apostles?
A. Stephen B. Ananias
C. Cornelius D. Philip

79. A traditional African practice which is also found in christianity is
A. offering sacrifices to God
B. naming children after ancestors
C. praying to God for our needs
D. preaching the Bible during worship

80. Which one of the following statements from the Apostle's creed teaches that Jesus is the son of God?
A. Descended into hell
B. Suffered under pontius pilate
C. Conceived by the Holy spirit
D. Crucified died and was buried

81. In which one of the following towns was David born?
A. Bethlehem B. Jerusalem
C. Bethany D. Jericho

82. Which one of these is a secular value?
A. Popularity B. Mercy
C. Charity D. Forgiveness

83. When people were wealthy in traditional African societies the **main** explanation given was that they were
A. blessed by God B. hardworking
C. generous D. wise

84. Below are class seven pupils who among them uses talents well according to the Biblical teachings?
A. June - sings in the church choir
B. Fridah - reads many story books
C. Dorcas - writes good poems
D. Jane - writes good composition

85. Which one of the following activities by Christians is an example of the gifts of the Holy spirit?
A. Reading the Bible
B. Collecting offerings
C. Cleaning the church
D. Singing in the choir

86. A class six teacher has asked the pupils to weed garden. John is not willing to do it because he fells it is manual work. As a Christian what is best advice to give him
A. ask other pupils to help him
B. transfer to another school
C. do the work quickly
D. do the work as well as he can

87. Mark your deskmate hides his Christian religious education textbook from you. As a christian what action would you take
A. stop talking to him
B. report him to the teacher
C. teach him about sharing
D. move away from the desk

88. Mary is a rich lady who has poor neighbours as a Christian the best advice to give her is that she should
A. give jobs to the needy
B. give them food
C. donate her money to the church
D. keep her money in a safe place

89. You have noticed that your friend Philip has been going out of school during class time and you would like him to stop. As a christian you should
A. go and tell his parents about it
B. show him why it is important to respect school rules
C. threaten to end your relationship with him
D. report the matter to the class prefect

90. Mary your schoolmate has joined a group of youths who smoke cigarettes. What would be the **best** thing for you to do
A. report her to the class teacher
B. advise her to transfer to another school
C. avoid any contact with her
D. tell her to stop the friendship

walimuepublishers@gmail.com

FOR MORE RESOURCES
CALL: 0705525657

FOR MORE RESOURCES CALL: 0705525657